Name: _____

Sr: 08102023-3223

October 08, 2023

MATHS WORKSHEET GENERATOR 11-PLUS SATS GCSES

1) **4** $^{15}/_{20}$ **- 19** $^{4}/_{11}$

Answer: _____

2) 45 x (-45)

Answer: _____

3) An amount was decreased by 4% to $191.99. Find the original amount.

Answer: _____

4) 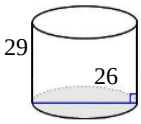

Find Volume of Cylinder

Answer: _____

5) Solve by factorising
$s^2 - 11s - 12 = 0$

Answer: _____

6) Round 16.0521824529 to the nearest whole number.

Answer: _____

7) Round 16.0521824529 to the nearest whole number.

Answer: _____

8) Round 16.0521824529 to the nearest whole number.

Answer: _____

9) Round 16.0521824529 to the nearest whole number.

Answer: _____

10) $118.00 earning 10.9% compound interest for 5 years.

Answer: _____

11) 976 + 314

Answer: _____

12) 351 - (-933)

Answer: _____

13) $^{19}/_{17}$ - $^{11}/_{18}$

Answer: _____

14) 20.4 x 12.8

Answer: _____

15) An amount was decreased by 5% to $236.00. Find the original amount.

Answer: _____

Copyright 2023 - Geek School Tutoring Limited

Name: _____

Sr: 08102023-3223

October 08, 2023

MATHS WORKSHEET GENERATOR 11-PLUS SATS GCSES

16) 400 ÷ 16

Answer: _____

17) An amount was increased by 2% to $286.67. Find the original amount.

Answer: _____

18) Find the mean of the following set of data:

4, 0.4

Answer: _____

19) Find the mean of the following set of data:

0.8, 0.2, 27, 10, 29

Answer: _____

20)

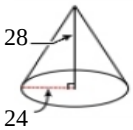

Volume of Cone

Answer: _____

21) Convert the following mixed number $15^{10}/_{5}$ into an improper fraction.

Answer: _____

22) 442 + 784

Answer: _____

23) $392.00 earning 3% compound interest for 9 years.

Answer: _____

24) 32.55 ÷ 21.7

Answer: _____

25) 20.3 x 35.9

Answer: _____

26) Solve by factorising

$f^2 - 3f - 4 = 0$

Answer: _____

27)

Measure angle boc

Answer: _____

28) $^{13}/_{18} + ^{13}/_{6}$

Answer: _____

29)

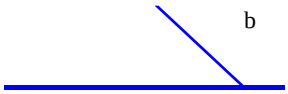

Measure angle boa

Answer: _____

30)

'Name the type of angle.

Answer: _____

Copyright 2023 - Geek School Tutoring Limited

Name: _____

Sr: 08102023-3223

October 08, 2023

MATHS WORKSHEET GENERATOR 11-PLUS SATS GCSES

31) 

'Name the type of angle.

Answer: _____

32) Convert the following improper fraction $13^{10}/_{17} + 4^{10}/_{11}$ into a mixed number

Answer: _____

33) 308 + 259

Answer: _____

34) 'What is the probability of rolling factors of 7.when rolling a dice

Answer: _____

35) 821 + 127

Answer: _____

36) 07:13 am To 03:25 pm

Answer: _____

37) 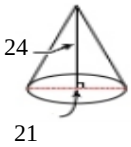

Find Volume of Cone

Answer: _____

38) 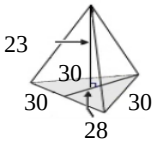

Find Volume of Triangular Pyramid

Answer: _____

39) 383.13 ÷ 29.7

Answer: _____

40) $^{2}/_{5} \div {}^{5}/_{11}$

Answer: _____

41) 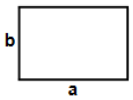

Find area of rectangle having sides a = 330 cm and b = 179 cm

Answer: _____

42) 109 - (-895)

Answer: _____

43) 735 ÷ 35

Answer: _____

44) 10:37 am To 02:56 pm

Answer: _____

45) Find the mode of the following set of data:

25, 25, 25, 25, 15, 15, 15, 15, 61, 61, 61

Answer: _____

Copyright 2023 - Geek School Tutoring Limited

Name: _____

Sr: 08102023-3223

October 08, 2023

MATHS WORKSHEET GENERATOR 11-PLUS SATS GCSES

46) $^{2}/_{9} \div {}^{5}/_{1}$

Answer: _____

47) 24.5 - 393.2

Answer: _____

48) Decrease 69 by 73%

Answer: _____

49) Decrease 69 by 73%

Answer: _____

50) 53.11 ÷ 11.3

Answer: _____

51) $20^{6}/_{11} \times 6^{4}/_{5}$

Answer: _____

52) 969 + 693

Answer: _____

53) 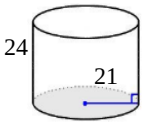

Find Volume of Cylinder

Answer: _____

54) An amount was decreased by 1% to $216.00. Find the original amount.

Answer: _____

55) Convert the following mixed number $8^{11}/_{19}$ into an improper fraction.

Answer: _____

56) Increase 21 by 16%

Answer: _____

57) Find the range of the following set of data:

-16, 0.1, 15, 20, 14

Answer: _____

58) Decrease 10 by $^{3}/_{5}$

Answer: _____

59) 875 ÷ 25

Answer: _____

60) (-46) x (-29)

Answer: _____

Copyright 2023 - Geek School Tutoring Limited

Name: _____

Sr: 08102023-3223

October 08, 2023

MATHS WORKSHEET GENERATOR 11-PLUS SATS GCSES

61)

'Name the type of angle.

Answer: _____

62) $(6^{-17})^{17}$

Answer: _____

63) Convert the following fraction into a mixed number: $^{25}/_{14}$

Answer: _____

64) $^{7}/_{6}$ - $^{5}/_{16}$

Answer: _____

65) Find the median of the following set of data:

4, 7, 21, 32, 11, 19, 10, 10, 37, 23

Answer: _____

66) 14.1 x 12.7

Answer: _____

67) 'What is the probability of rolling a even prime number.when rolling a dice

Answer: _____

68) $18^{8}/_{10} \div 7^{10}/_{11}$

Answer: _____

69)

'Name the type of angle.

Answer: _____

70) 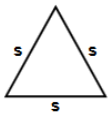

Find area of triangle s = 110 in

Answer: _____

71) (-888) ÷ 37

Answer: _____

72) 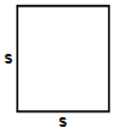

Find perimeter of square having each side (s) equals 128 m

Answer: _____

73) 702.1 + 534

Answer: _____

74) 702.1 + 534

Answer: _____

75) Convert the following mixed number $1^{17}/_{10}$ into an improper fraction.

Answer: _____

Copyright 2023 - Geek School Tutoring Limited

Name: _____

Sr: 08102023-3223

October 08, 2023

MATHS WORKSHEET GENERATOR 11-PLUS SATS GCSES

76) Increase 13.2 by 50%

Answer: _____

77) Convert the following fraction into a mixed number: $^{11}/_{1}$

Answer: _____

78) Find the median of the following set of data:

21, 17, 14, 11, 32, 22, 5, 18, 13, 35, 25, 11, 5, 10

Answer: _____

79) An amount was decreased by 5% to $477.00. Find the original amount.

Answer: _____

80) 417.6 - 150.3

Answer: _____

81) 417.6 - 150.3

Answer: _____

82) 417.6 - 150.3

Answer: _____

83) $3^{1}/_{17} \div 4^{1}/_{2}$

Answer: _____

84) $15^{2}/_{12} \times 11^{3}/_{4}$

Answer: _____

85) Decrease 15.6 by 7%

Answer: _____

86) 456 ÷ 19

Answer: _____

87) 661.6 - 563.2

Answer: _____

88) 29 x 100

Answer: _____

89) 43 x 10

Answer: _____

90) 43 x 10

Answer: _____

Copyright 2023 - Geek School Tutoring Limited

Name: _____

Sr: 08102023-3223

October 08, 2023

MATHS WORKSHEET GENERATOR 11-PLUS SATS GCSES

91) 43 x 10

Answer: _____

92) Convert the following improper fraction $2^{8}/_{10} + 4^{3}/_{11}$ into a mixed number

Answer: _____

93) $1^{9}/_{20} \div 18^{14}/_{15}$

Answer: _____

94) 958 - (-329)

Answer: _____

95) 958 - (-329)

Answer: _____

96) $^{15}/_{15} - {}^{1}/_{18}$

Answer: _____

97) Simplify 17:6

Answer: _____

98) Convert the following fraction into a mixed number: $^{5}/_{1}$

Answer: _____

99) Find the range of the following set of data:

4, -3, 0.2, -14

Answer: _____

100) Convert the following mixed number $2^{18}/_{4}$ into an improper fraction.

Answer: _____

Total: ___ / 100

Copyright 2023 - Geek School Tutoring Limited

Name: _____

Sr: 08102023-3223

October 08, 2023

MATHS WORKSHEET GENERATOR 11-PLUS SATS GCSES

Answers:

1) $29^{27}/_{44}$	2)	3) $184.31	4) 15396.945595244	5) s = 12 or -1	6) 16	7) 16
8) 16	9) 16	10) $197.94	11) 1290	12) 1284	13) $^{155}/_{306}$	14) 261.12
15) $224.20	16) 25	17) $281.05	18) 2.2	19) 13.4	20) 16889.202105699	21) $^{17}/_{1}$
22) 1226	23) $511.47	24) 1.5	25) 728.77	26) f = 4 or -1	27) 24	28) $2^{8}/_{9}$
29) 43	30) Obtuse	31) Obtuse	32) $18^{93}/_{187}$	33) 567	34) $^{1}/_{6}$	35) 948
36) 08 Hours 12 Mins	37) 2770.8847204662	38) 3220	39) 12.9	40) $^{22}/_{25}$	41) 59070cm	42) 1004
43) 21	44) 04 Hours 19 Mins	45) 25	46) $^{2}/_{45}$	47) -368.7	48) 18.63	49) 18.63
50) 4.7	51) $139^{39}/_{55}$	52) 1662	53) 33250.616645594	54) $213.84	55) $^{163}/_{19}$	56) 24.36
57) 36	58) 4	59) 35	60)	61) Obtuse	62) 6^{-289}	63) $1^{11}/_{14}$
64) $^{41}/_{48}$	65) 15	66) 179.07	67) $^{1}/_{6}$	68) $2^{164}/_{435}$	69) Obtuse	70) 5239.4536928959in
71) -24	72) 512m	73) 1236.1	74) 1236.1	75) $^{27}/_{10}$	76) 19.8	77) 11
78) 11.5	79) $453.15	80) 267.3	81) 267.3	82) 267.3	83) $^{104}/_{153}$	84) $178^{5}/_{24}$
85) 14.508	86) 24	87) 98.4	88) 2900	89) 430	90) 430	91) 430
92) $7^{4}/_{55}$	93) $^{87}/_{1136}$	94) 1287	95) 1287	96) $^{17}/_{18}$	97) 17 : 6	98) 5
99) 18	100) $^{13}/_{2}$					

Copyright 2023 - Geek School Tutoring Limited